YEAR 1

Place value (within 50)

- One more, one less
- Compare objects within 50
- Compare numbers within 50

PrimaryStars EDUCATION

Block 2 – Week 6

© Primary Stars Education

Lesson 1

Step: One more, one less

© Primary Stars Education

Complete the sentences.



There are 25 apples

One more than 25 is 26, one less than 25 is 24.

© Primary Stars Education

Complete the sentences.

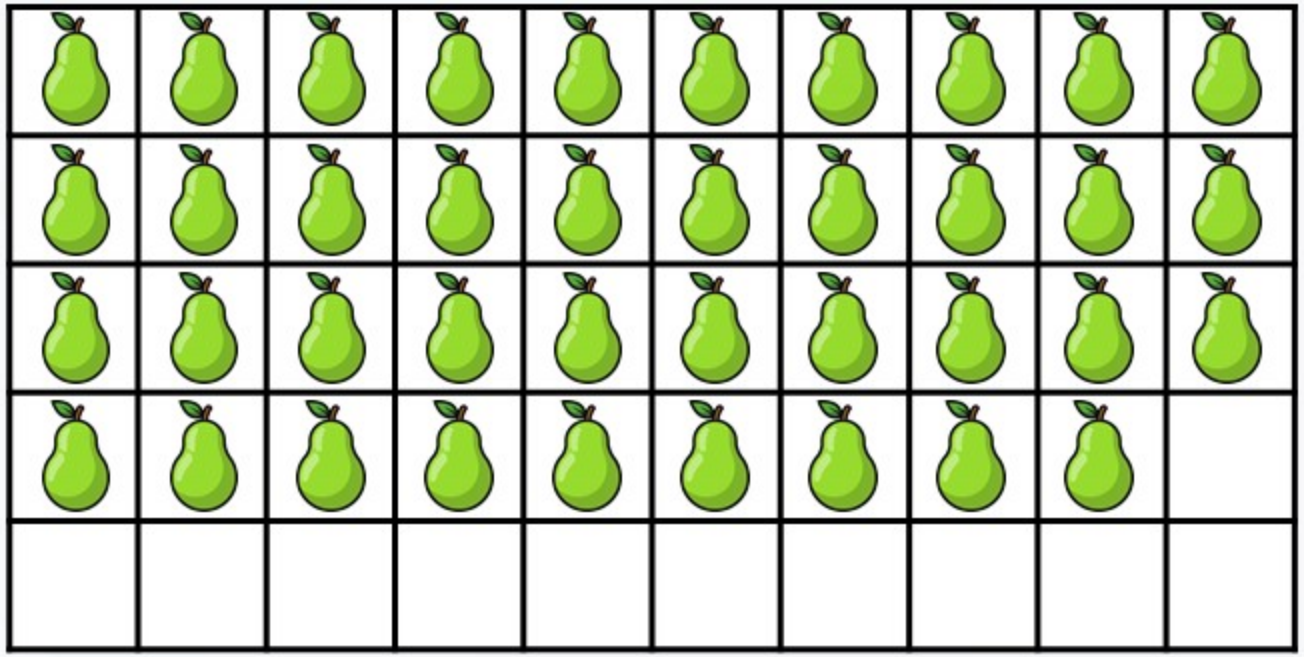

There are 39 pears.

One more than 39 is 40, one less than 39 is 38.

© Primary Stars Education

Complete the sentences.

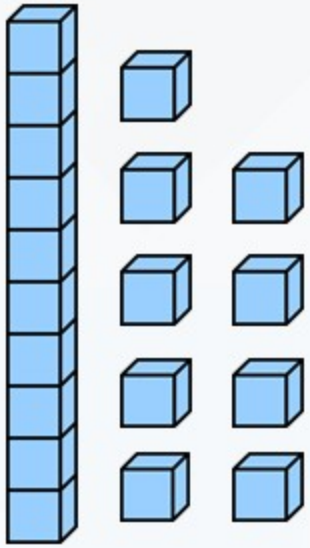

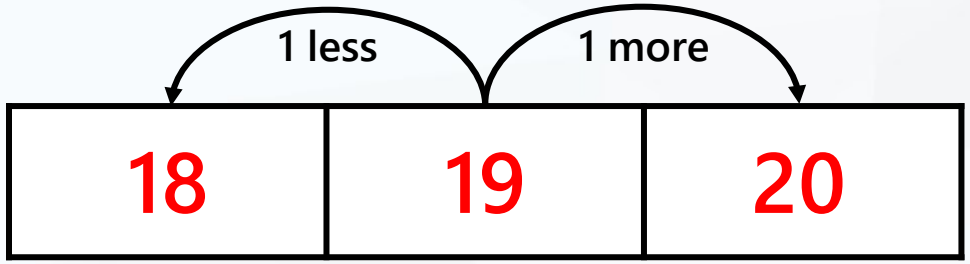

One more than 19 is 20.

One less than 19 is 18.

© Primary Stars Education

Complete the sentences.

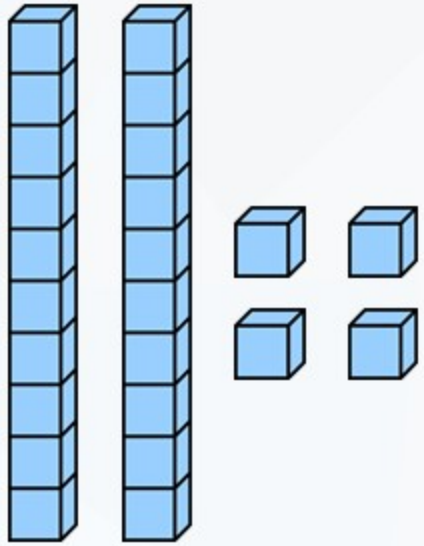

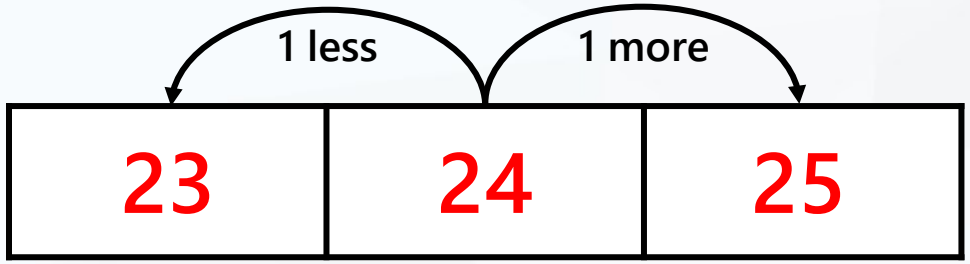

One more than 24 is 25.

One less than 24 is 23.

© Primary Stars Education

Complete the sentences.

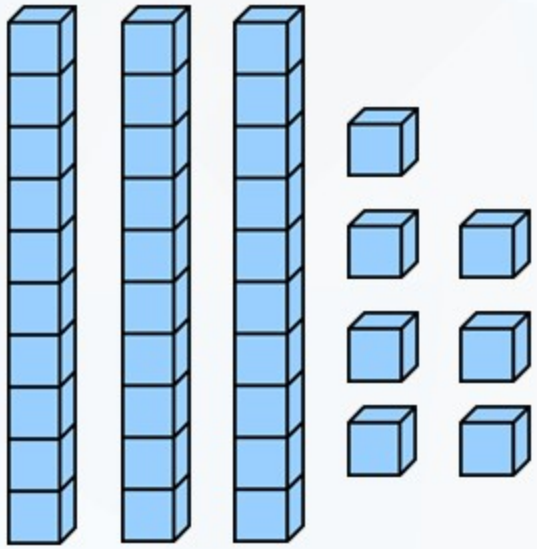

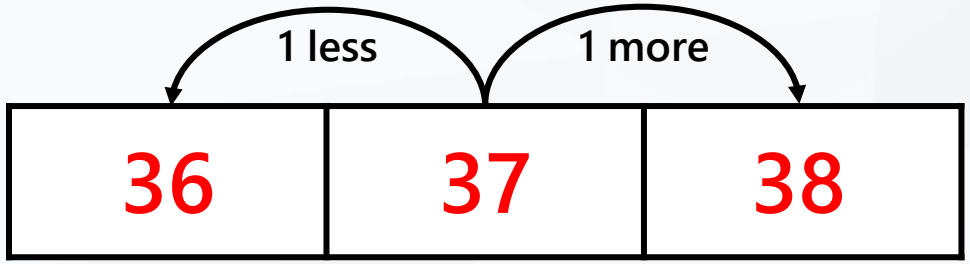

One more than 37 is 38.

One less than 37 is 36.

© Primary Stars Education

Complete the sentences.

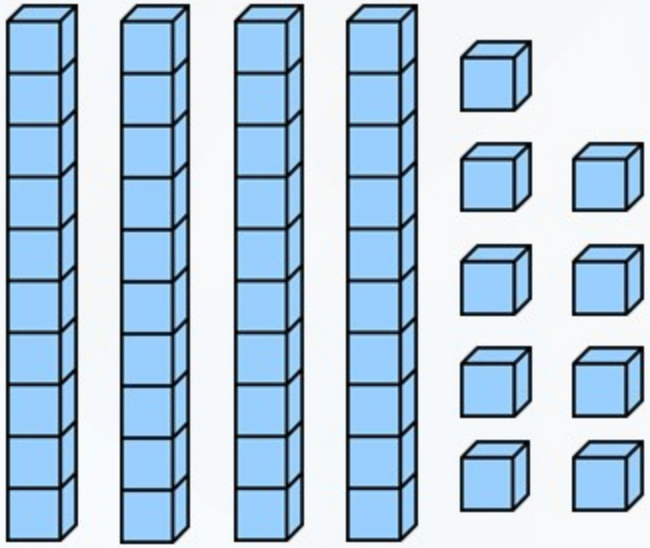

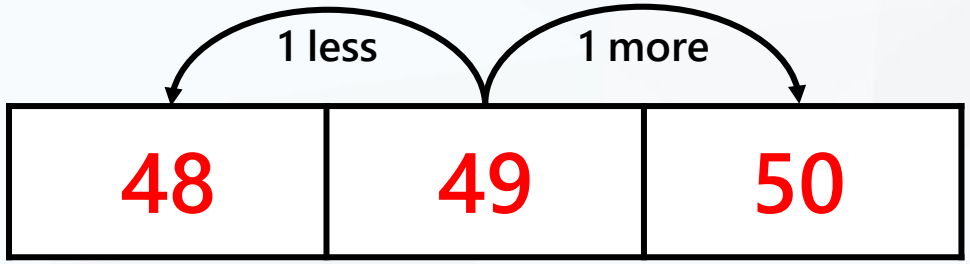

One more than ___49___ is ___50___.

One less than ___49___ is ___48___.

© Primary Stars Education

Complete the sentences.

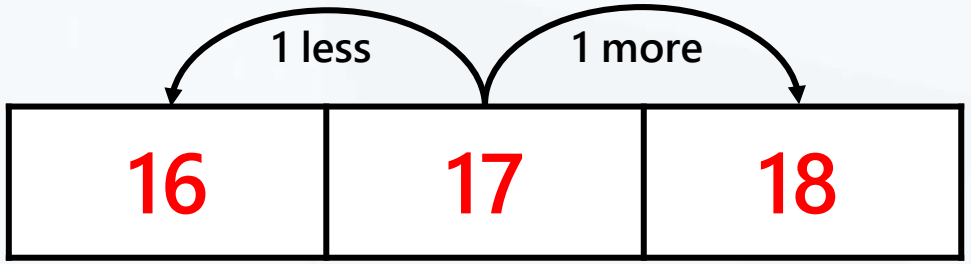

One more than 17 is 18.

One less than 17 is 16.

© Primary Stars Education

Complete the sentences.

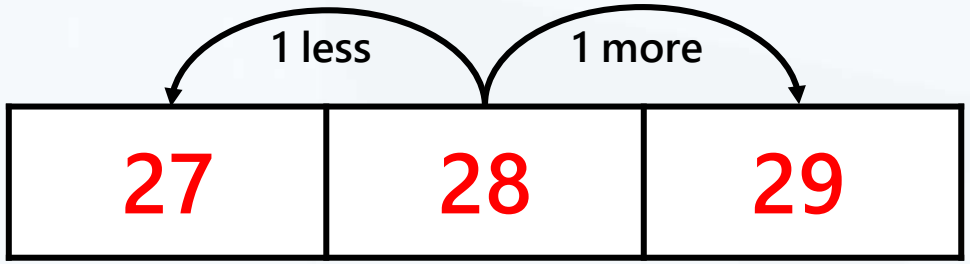

One more than 28 is 29.

One less than 28 is 27.

© Primary Stars Education

Complete the sentences.



One more than 36 is 37.

One less than 36 is 35.

© Primary Stars Education

Kat says,

The table I have completed is correct.

One less	Number	One more
18	19	20
25	24	23
31	32	33
47	48	49

Is Kat correct? Explain your answer.

No, Kat has put the number 25 and 23 in the wrong columns. They need to be swapped around.

© Primary Stars Education

Problem solving

Complete the sentences below.

One more than 39 is one less than 41.

One more than 36 is one less than 38.

© Primary Stars Education

Lesson 2

Step: Compare objects within 50

(Practical)

© Primary Stars Education

Compare the pictures using more than, less than or equal to.

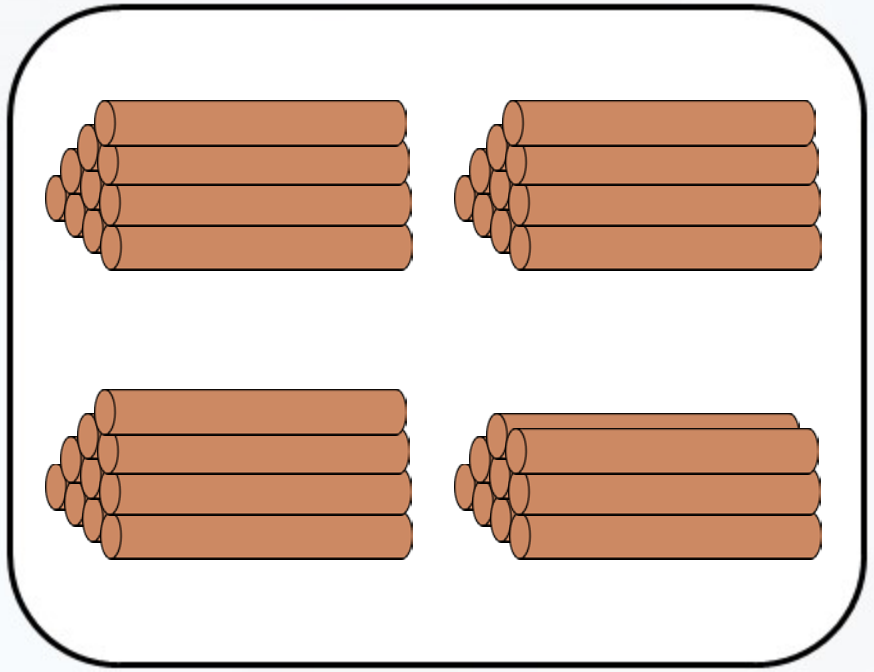

more than

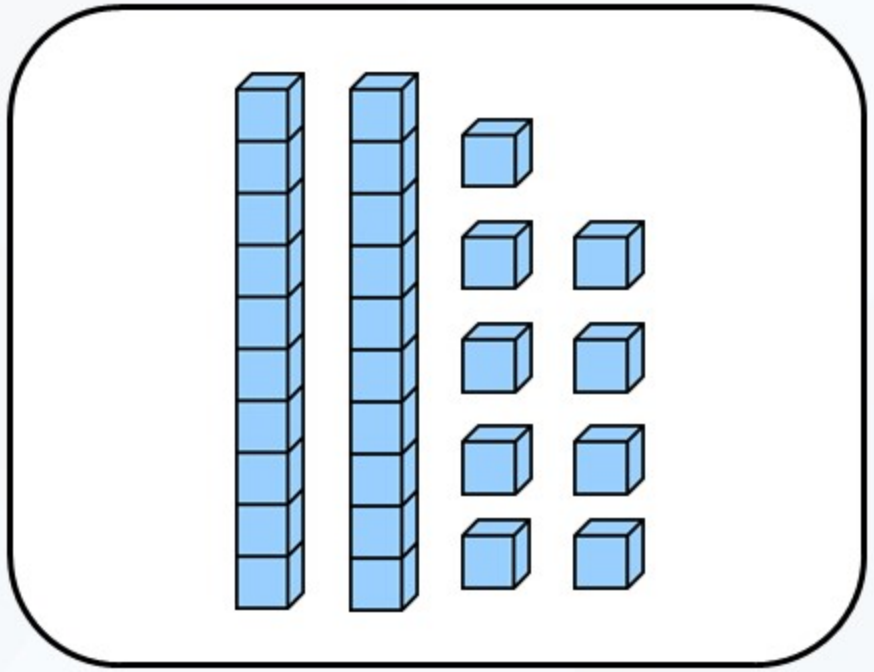

© Primary Stars Education

Compare the pictures using more than, less than or equal to.

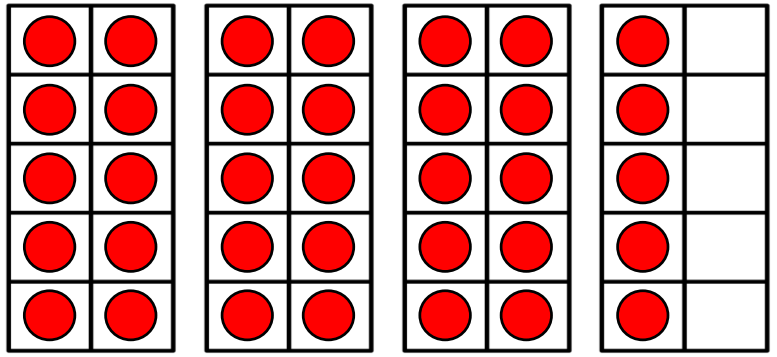

equal to

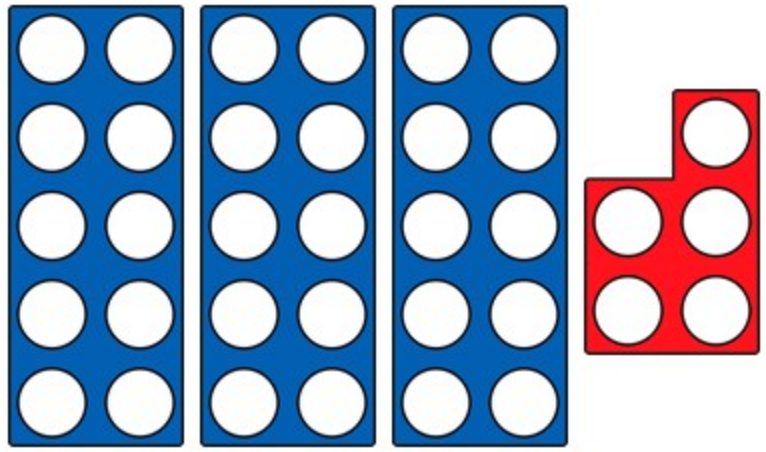

© Primary Stars Education

Compare the pictures using more than, less than or equal to.

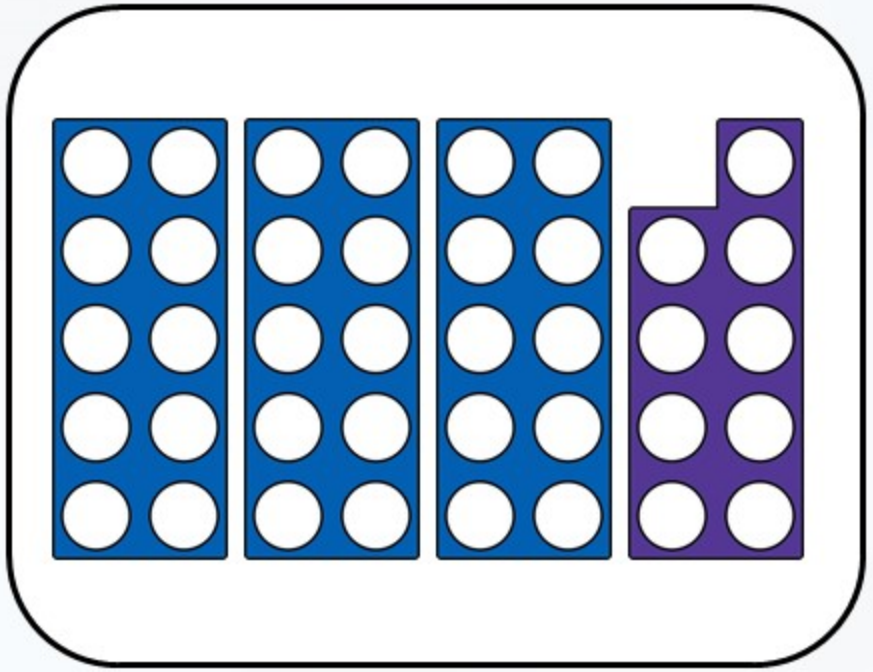

less than

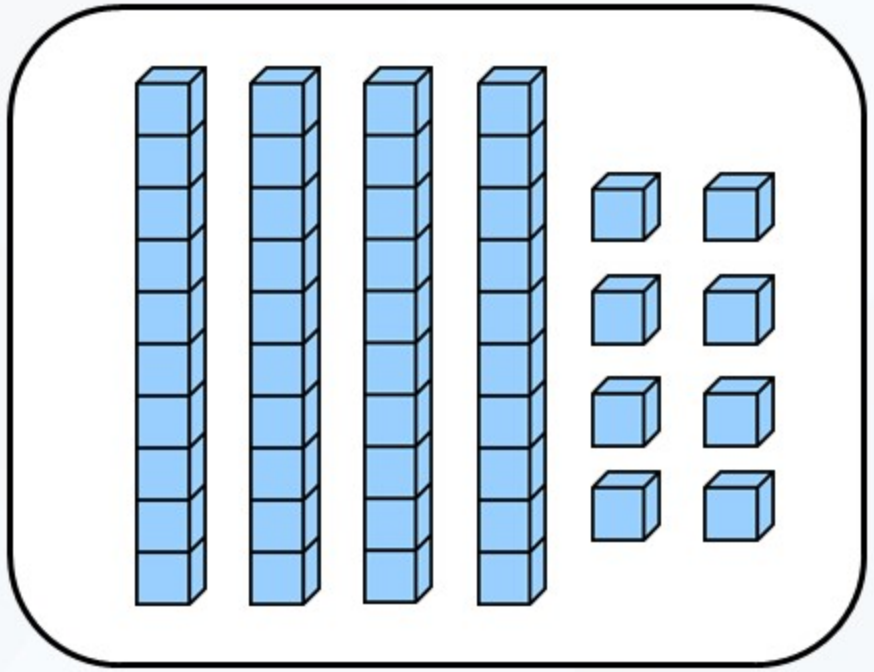

© Primary Stars Education

Compare the pictures using the comparison signs >, < or =.

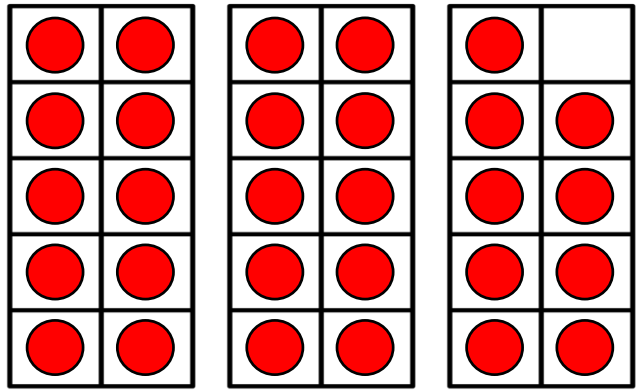

=

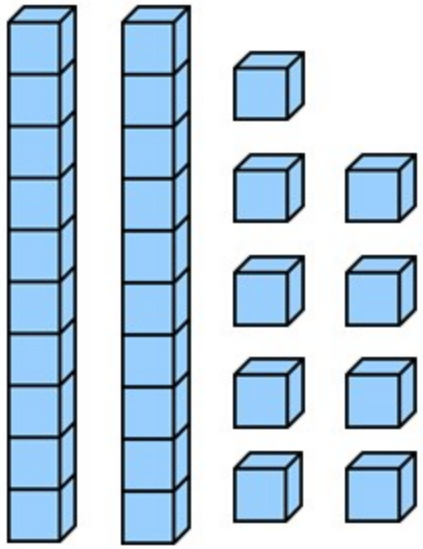

© Primary Stars Education

Compare the pictures using the comparison signs >, < or =.

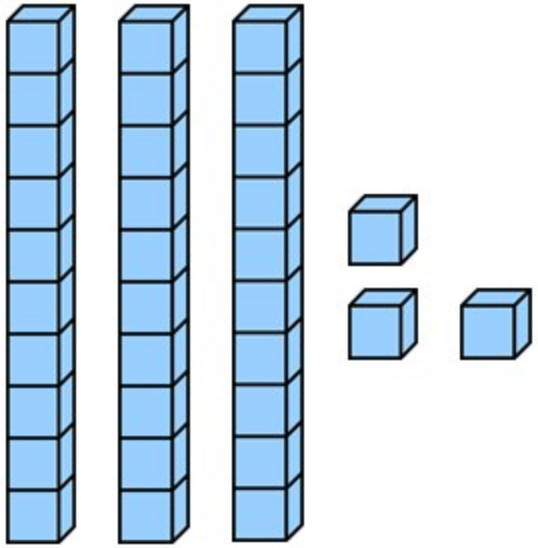

<

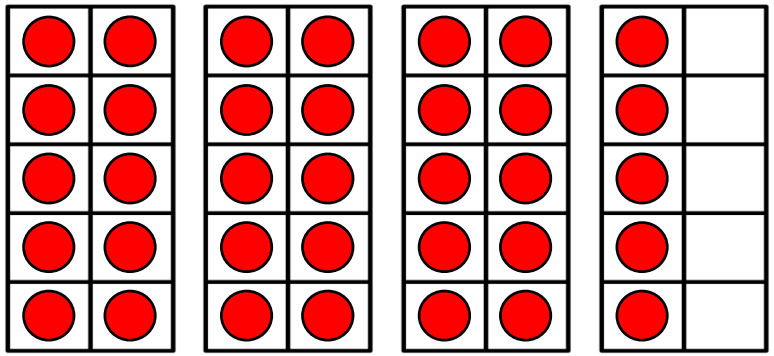

© Primary Stars Education

Compare the pictures using the comparison signs >, < or =.



>

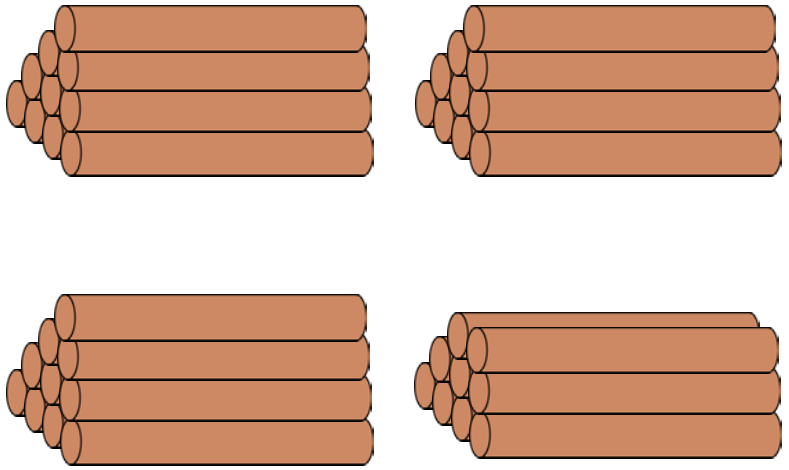

© Primary Stars Education

Spot the mistake.

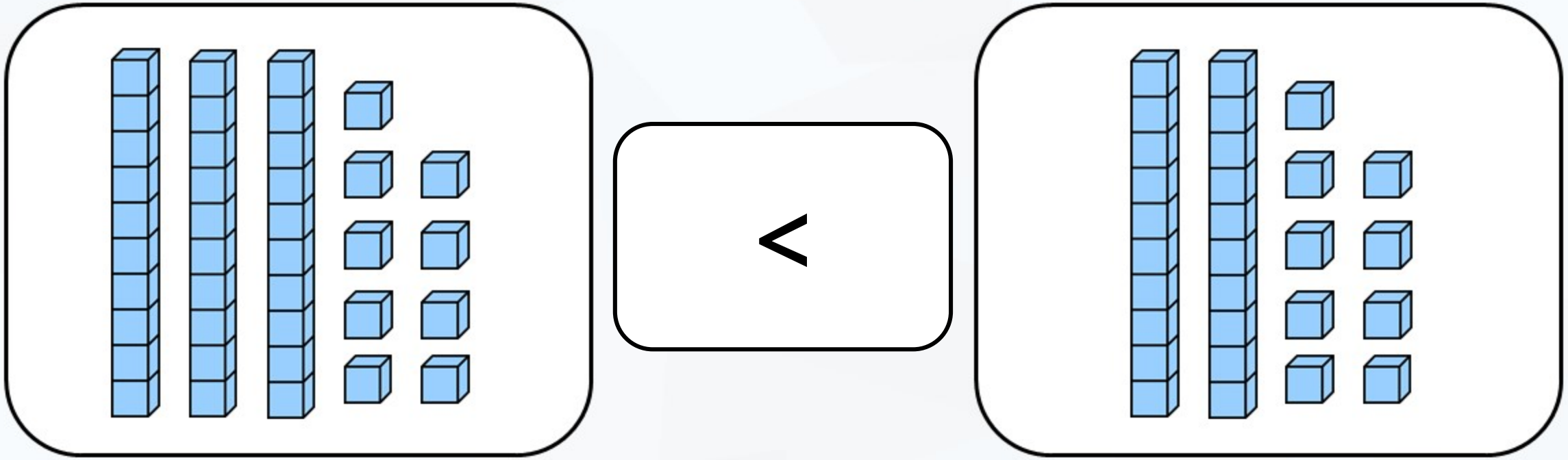

Explain your answer.

The should be > (greater than) not <.
39 > 29.

© Primary Stars Education

Problem solving

Which representations show more than 26?



© Primary Stars Education

Lesson 3

Step: Compare objects within 50

© Primary Stars Education

Complete the sentences.

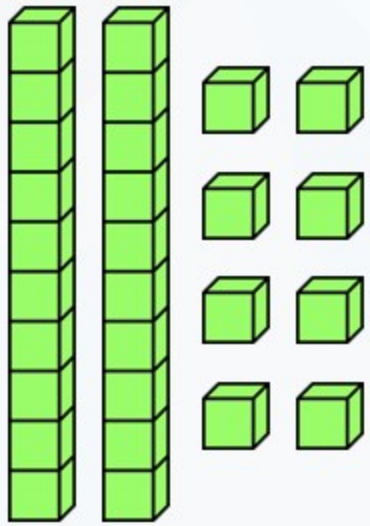

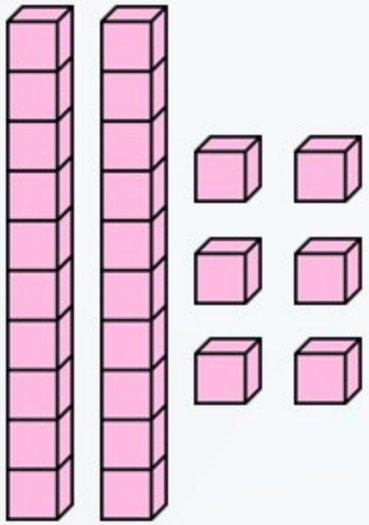

28 is more than 26.

26 is less than 28.

© Primary Stars Education

Complete the sentences.

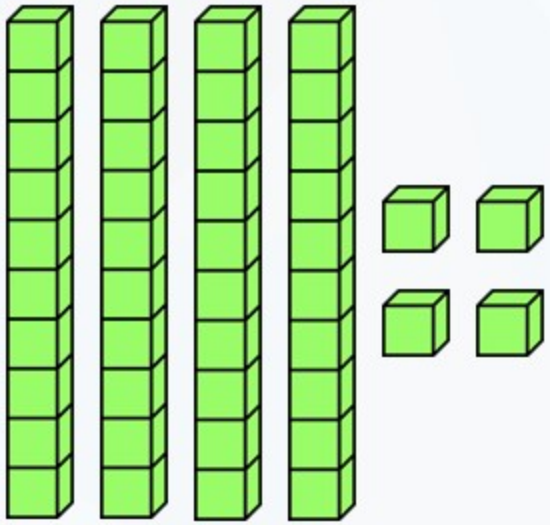

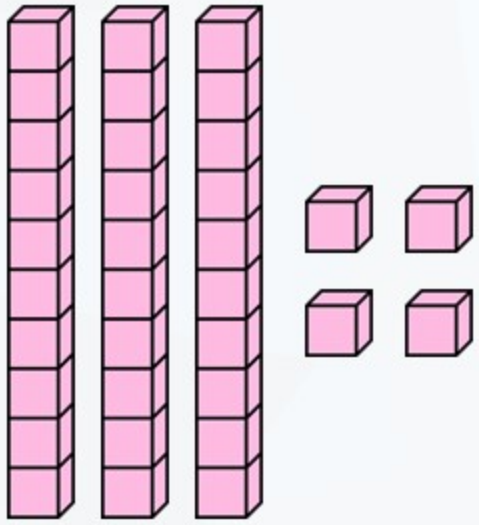

44 is more than 34.

34 is less than 44.

© Primary Stars Education

Complete the sentences.

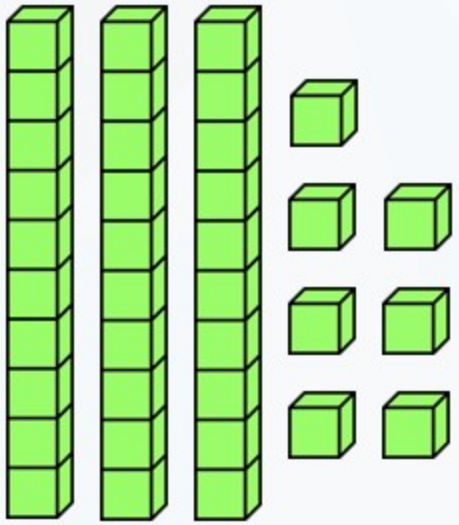

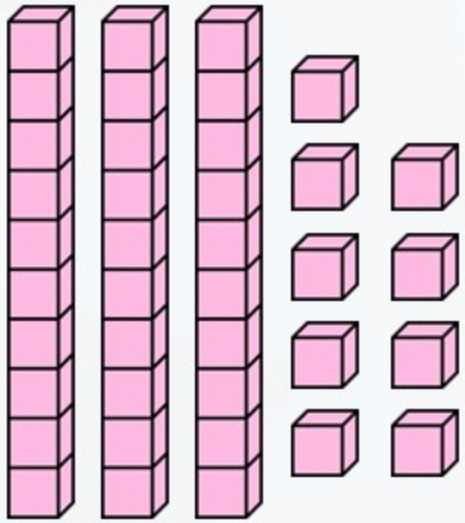

39 is more than 37.

37 is less than 39.

© Primary Stars Education

Complete the comparison sentences.

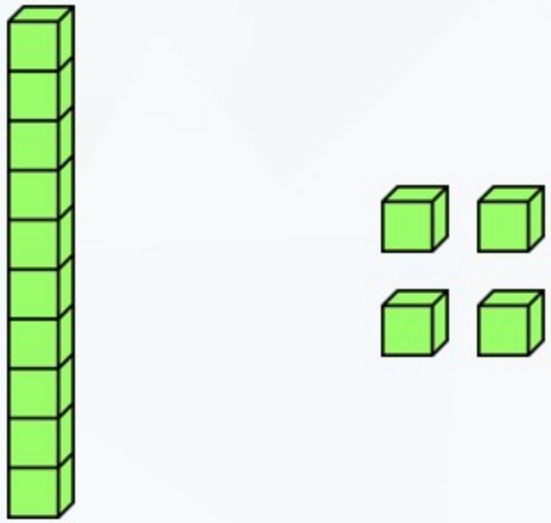

14 > 13

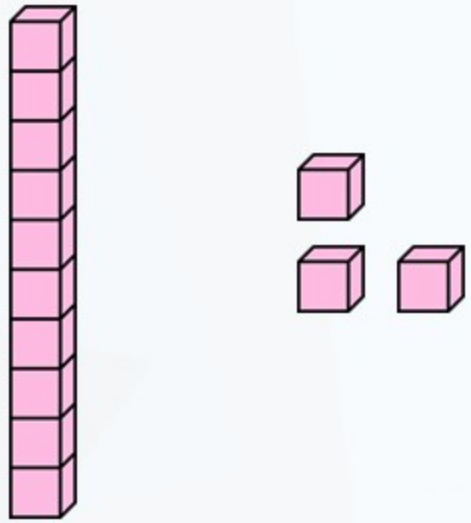

13 < 14

© Primary Stars Education

Complete the comparison sentences.

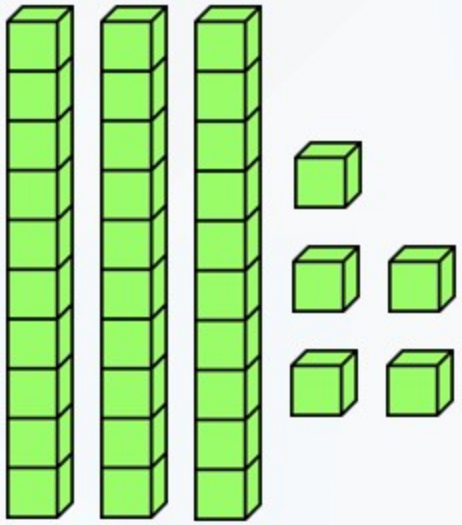

35 > 32

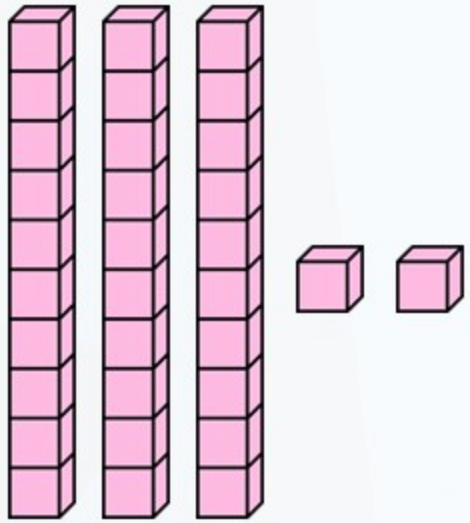

32 < 35

© Primary Stars Education

Complete the comparison sentences.

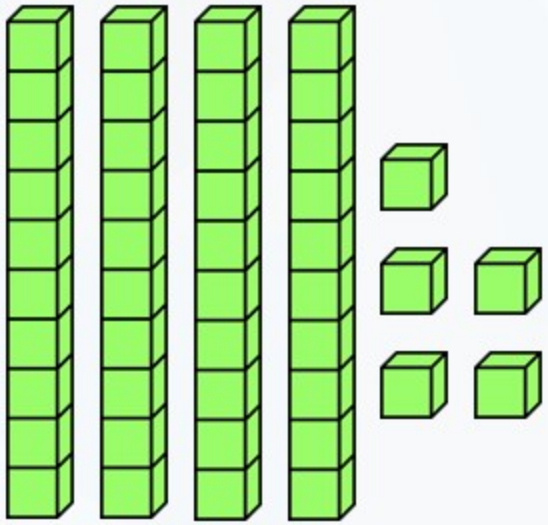

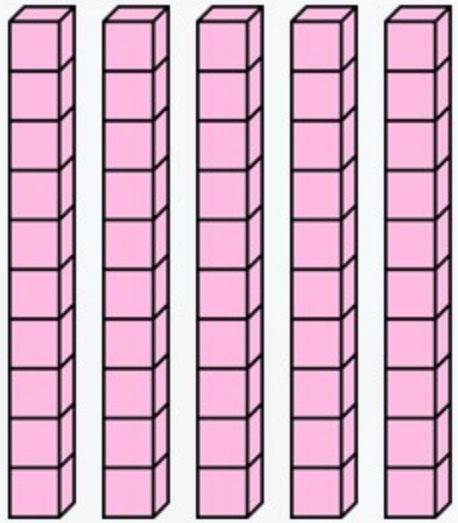

50 > 45

45 < 50

© Primary Stars Education

Complete the comparisons table.

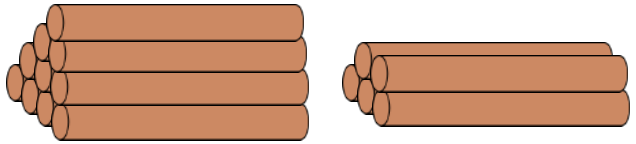	=	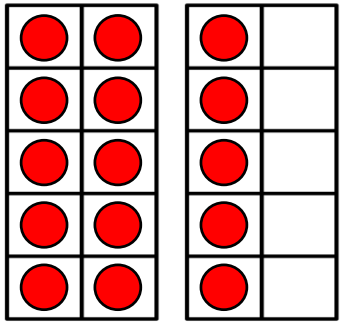

© Primary Stars Education

Complete the comparisons table.

	>	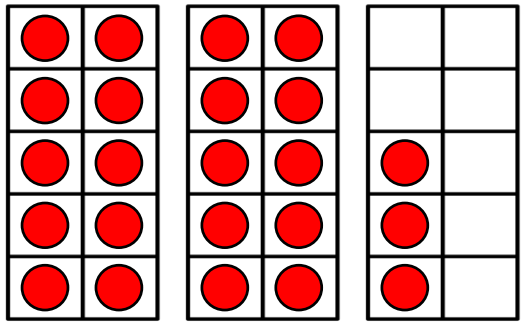

© Primary Stars Education

Spot the mistake.

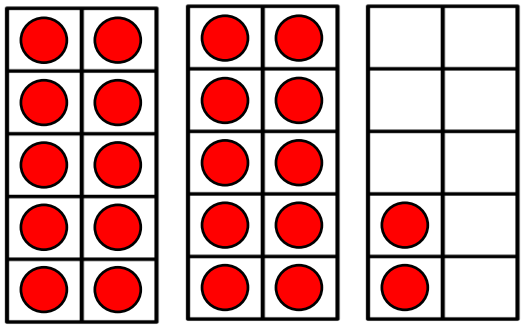	<	
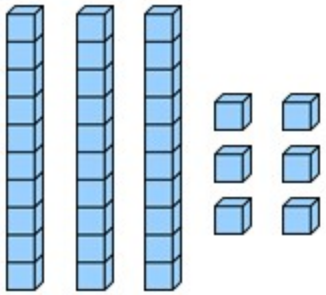	<	
	>	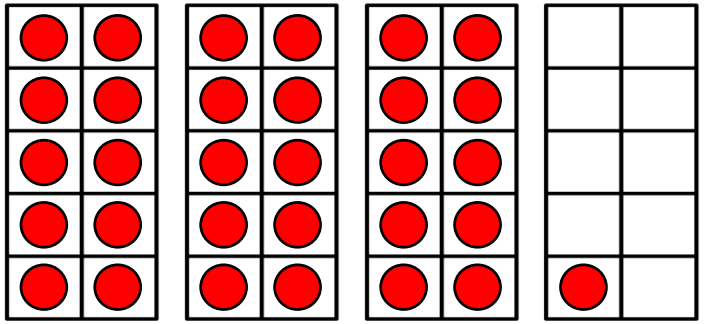

The middle comparison sign is the wrong way round. It should be >.

© Primary Stars Education

Rob asks,



What can Rob change?

Rob could add one stick to the right side to make both sides 23.

© Primary Stars Education

Lesson 4

Step: Compare numbers to 50

(Practical)

© Primary Stars Education

Fluency

Compare the numbers using more than, less than or equal to.

49	more than	36
19	less than	21
36	equal to	36

© Primary Stars Education

Fluency

Compare the numbers using more than, less than or equal to.

46	less than	36
19	more than	18
23	less than	32

© Primary Stars Education

Fluency

Compare the numbers using the comparison signs >,< or =.

40	>	20
37	<	39
19	>	9

© Primary Stars Education

Fluency

Compare the numbers using the comparison signs >,< or =.

42 > 10 < 13

© Primary Stars Education

Tam says,

34 + 1 equals one less than 35

Is Tam correct?

Explain your answer.

Tam is not correct. 34 + 1 = 35.
This is not less than 35 which is 34.

© Primary Stars Education

Problem solving

The missing digit card is between 30 and 40.

?	>	36

What numbers could the digit card be?

37, 38 or 39.

© Primary Stars Education

Lesson 5

Step: Compare numbers to 50

© Primary Stars Education

Use the number track to help you complete the comparison sentences.

31	32	33	34	35	36	37	38	39	40

36 is ___less___ than 39.

39 is ___more___ than 36.

© Primary Stars Education

Use the number track to help you complete the comparison sentences.

28	29	30	31	32	33	34	35	36	37

29 is less than 32.

32 is more than 29.

© Primary Stars Education

Use the number track to help you complete the comparison sentences.

19	20	21	22	23	24	25	26	27	28

19 ___<___ 28.

28 ___>___ 19.

© Primary Stars Education

Fluency

Use the number track to help you complete the comparison sentences.

38	39	40	41	42	43	44	45	46	47

41 ___<___ 42.

42 ___>___ 41.

© Primary Stars Education

Complete the comparisons.

41	42	43	44	45	46	47	48	49	50

49	is more than	46
46	is less than	49

© Primary Stars Education

Complete the comparisons.

26	27	28	29	30	31	32	33	34	35

33	is more than	28
28	is less than	33

© Primary Stars Education

Fluency

Use the 1 to 50 grid to help you complete the comparisons.

28	>	21
19	<	25
38	<	43
twenty	=	20
thirty-two	>	thirty

1	2	3	4	5	6	7	8	9	10
11	12	13	14	15	16	17	18	19	20
21	22	23	24	25	26	27	28	29	30
31	32	33	34	35	36	37	38	39	40
41	42	43	44	45	46	47	48	49	50

© Primary Stars Education

Use the 1 to 50 grid to help you complete the comparison questions.

1	2	3	4	5	6	7	8	9	10
11	12	13	14	15	16	17	18	19	20
21	22	23	24	25	26	27	28	29	30
31	32	33	34	35	36	37	38	39	40
41	42	43	44	45	46	47	48	49	50

34 + 5 ___>___ 33 + 4

29 - 7 ___<___ 28 - 5

© Primary Stars Education

Matt says that the comparison is correct.

$$\boxed{43} > \boxed{43}$$

Is Matt correct?
If not, how could he correct his mistake?

Matt is not correct.
He could swap the second 43 around to make 34.
That would make the comparison correct.

© Primary Stars Education

Che says,

The missing answer is an odd number.

22 > ?

What could the numbers be?

21, 19, 17, 15, 13, 11, 9, 7, 5, 3, 1

How many different possibilities are there?

11

© Primary Stars Education